Collaborative Grid Drawing

Reference | Numbered reference | A4

Use cells 1–3 across the first row, and 4–6 across the second row.

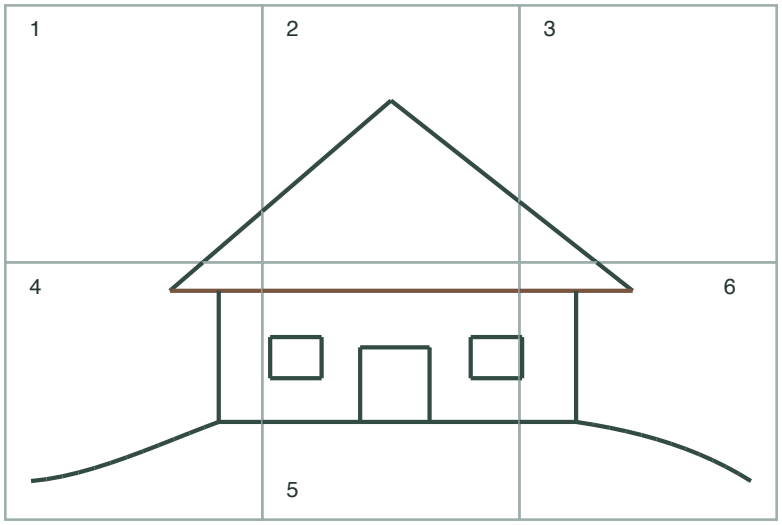

Collaborative Grid Drawing

Reference | Worked example | A4

Original prompt

Describe how a learner would enlarge cell 4 of a house-on-a-hill reference and check it against its neighbours.

Reference cell

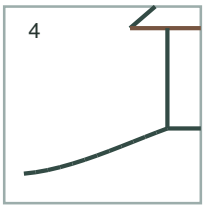

Enlarged copy

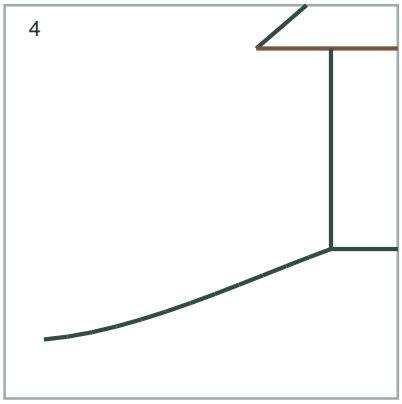

Answer

Find cell 4 at bottom left. Match the left roof slope at the top boundary and the straight eave where it leaves the right edge. Draw the short wall and the rising hill segment that meets the house base. The upper seam matches cell 1 and the right seam matches cell 5.

Reasoning

Enlarge the same unit positions inside a bigger square without shifting where marks meet shared edges. Cell 1 is above cell 4, and cell 5 is to its right.

Check

Compare the enlarged cell 4 with its reference. Check the roof slope against cell 1 above, and the eave and house base against cell 5 at the right.