Skull Grid Drawing

Answer I Task 1 of 4 I A4

Original prompt

Task 1: On the blank grid, copy only the cranium outline from the gridded reference skull, cell by cell.

Reference grid



Model copy

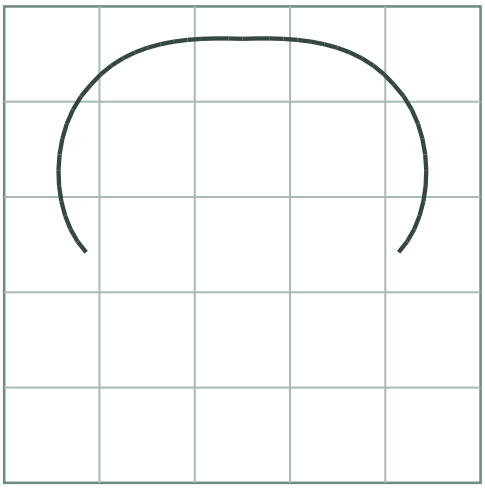

Answer

The upper cranium is one continuous arc from the left cheek junction to the right cheek junction, open below in this partial key. Copy that visible arc at the same positions in the blank grid; do not add cheekbones or a lower cranium edge.

Reasoning

Copying one feature at a time keeps attention on boundary crossings, which is what preserves proportion.

Check

Place the blank grid beside the full reference. Compare the open upper cranium arc cell by cell, matching its two cheek-junction endpoints and the visible boundary crossings; leave all other features blank.

Skull Grid Drawing

Answer | Task 2 of 4 | A4

Original prompt

Task 2: On the blank grid, copy the eye sockets and nasal opening from the gridded reference, placing each in its matching cell.

Reference grid



Model copy

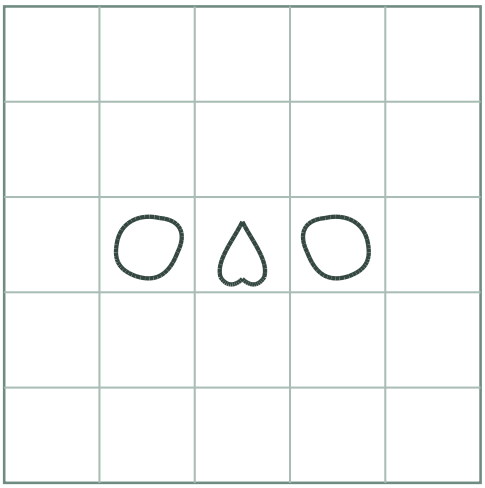

Answer

Each eye-socket loop is wholly inside row 3, column 2 or row 3, column 4; the nasal opening is in row 3, column 3. Copy those three features at the same visible positions and shapes as the reference, leaving the spaces between them and all other requested cells as shown.

Reasoning

Placing features by cell rather than by eye keeps their relative positions correct.

Check

Keep both grids visible side by side. Compare row 3, columns 2–4: the two socket loops and central nasal opening should occupy the same cells and positions as in the reference.

Skull Grid Drawing

Answer I Task 3 of 4 I A4

Original prompt

Task 3: On the blank grid, copy the cheekbones and jaw line from the gridded reference, cell by cell.

Reference grid



Model copy

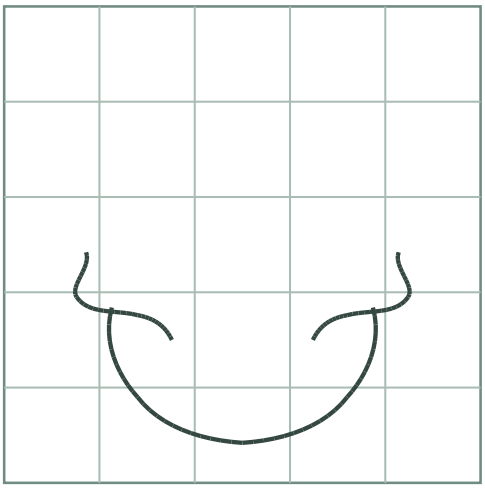

Answer

The cheekbone edges and jaw line are drawn so each enters and leaves its cells at the same boundary points as the reference, and the lower cells hold the same jaw content. Empty cells stay empty.

Reasoning

Lower-face features are easy to drift, so matching boundary crossings in each cell keeps them aligned.

Check

Read the lower cells of both grids and confirm the jaw and cheekbone content and boundary crossings match.

Skull Grid Drawing

Answer | Task 4 of 4 | A4

Original prompt

Task 4: On the blank grid, complete the full skull copy from the gridded reference, then check it cell by cell.

Reference grid



Model copy



Answer

The completed copy matches the full reference across all 25 cells: the continuous upper cranium arc from the left cheek junction to the right cheek junction, with the cheekbones meeting its endpoints and the jaw forming the lower contour; socket loops in row 3 columns 2 and 4; nasal opening in row 3 column 3; and stylized teeth. This describes the chosen teaching drawing and makes no anatomical feature-count claim.

Reasoning

A full copy tests whether the cell method holds across the whole skull, not just single features.

Check

Keep the complete reference visible beside the copy and compare all 25 cells. Check the same feature placement and visible boundary crossings in each corresponding cell, then correct any mismatch.