Draw a Castle in Two-Point Perspective

Student | Task 1 of 4 | LETTER

Original prompt

Task 1: Draw a single castle tower in two-point perspective. Include a front corner edge, two wall planes, and a roof plane on top.

Your drawing and straightedge check



Draw a Castle in Two-Point Perspective

Student | Task 2 of 4 | LETTER

Original prompt

Task 2: Draw a castle with two connected towers of different heights, sharing a wall plane. Show corner edges and roof planes on both towers.

Your drawing and straightedge check



Draw a Castle in Two-Point Perspective

Student | Task 3 of 4 | LETTER

Original prompt

Task 3: Draw a castle with a main keep and a lower curtain wall in front. Show the corner edges of the keep and the roof planes of both the keep and the curtain wall.

Your drawing and straightedge check



Draw a Castle in Two-Point Perspective

Student | Task 4 of 4 | LETTER

Original prompt

Task 4: Draw a castle with a gatehouse and two flanking towers. Show corner edges, wall planes, and roof planes, and check that the nearest corner edge is the tallest.

Your drawing and straightedge check