Tiger Grid Drawing

Answer | Task 1 of 4 | LETTER

Original prompt

Task 1: Copy the ear square. The reference square shows the rounded top of the tiger's right ear and one short stripe inside it. Draw that content in the matching blank square.

Reference square B2



Model square B2



Answer

The completed square shows a rounded ear curve in the upper half and one short stripe inside the ear, angled the same way as the reference.

Reasoning

The ear curve is the largest shape, so drawing it first sets the position for the stripe inside it.

Check

Compare with the reference square: the ear curve should occupy the same part of the square and the stripe should point the same way.

Tiger Grid Drawing

Answer | Task 2 of 4 | LETTER

Original prompt

Task 2: Copy the muzzle square. The reference square shows the nose tip, the mouth line below it, and two short whisker marks. Draw them in the matching blank square.

Reference square C4



Model square C4



Answer

The completed square shows the nose tip in the upper middle, the mouth line curving below it, and two short whisker marks on either side.

Reasoning

The nose tip is the anchor; the mouth line and whisker marks are placed relative to it, matching the reference's arrangement.

Check

Check that the nose sits at the same height as in the reference and that the mouth line and whisker marks point the same way.

Tiger Grid Drawing

Answer | Task 3 of 4 | LETTER

Original prompt

Task 3: Copy the cheek-stripe square. The reference square shows two curved stripes running from the cheek toward the jaw. Draw both stripes in the matching blank square.

Reference square B4



Model square B4



Answer

The completed square shows two curved stripes, the upper one starting near the top edge and the lower one starting slightly below it, both curving toward the jaw side.

Reasoning

Drawing the upper stripe first gives a reference line for spacing the lower stripe, matching the reference's gap between them.

Check

Compare each stripe's start and end points with the reference square; both should sit in the same parts of the square.

Tiger Grid Drawing

Answer | Task 4 of 4 | LETTER

Original prompt

Task 4: Copy the shoulder square. The reference square shows the top edge of the tiger's shoulder and three short stripes below it. Draw the shoulder edge and the three stripes in the matching blank square.

Reference square F5



Model square F5



Answer

The completed square shows the shoulder edge running across the upper part of the square and three short stripes below it, spaced like the reference.

Reasoning

The shoulder edge is the largest line, so it is drawn first; the three stripes are then placed below it with spacing copied from the reference.

Check

Check that the shoulder edge is in the same position and that the three stripes are spaced and angled like the reference square.