Marching Band Drill Chart

Answer | Task 1 of 4 | A4

Original prompt

Task 1: Draw a blank field grid with sidelines, end zones, a center line, and evenly spaced yard lines, and label the yard lines along one sideline.

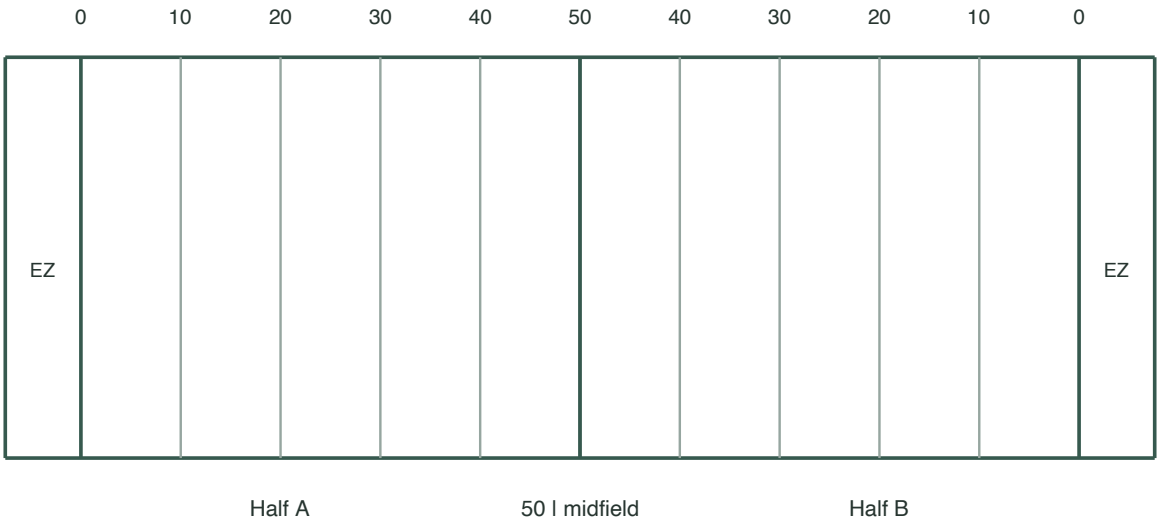

EZ means end zone. Yard labels repeat by half.

Answer

A field rectangle with two sidelines, two end zones, a marked center line, evenly spaced yard lines across the width from sideline to sideline, and yard-line labels along one sideline.

Reasoning

The grid must be readable before any performer is placed; even spacing and clear labels make later positions unambiguous.

Check

Verify the yard lines are evenly spaced, the center line is marked, and every label sits beside the line it names.

Marching Band Drill Chart

Answer | Task 2 of 4 | A4

Original prompt

Task 2: Using the blank grid shown in the Task 2 figure, place a six-performer section on the 30-yard line, evenly spaced across the field, using one consistent symbol and a stated key.

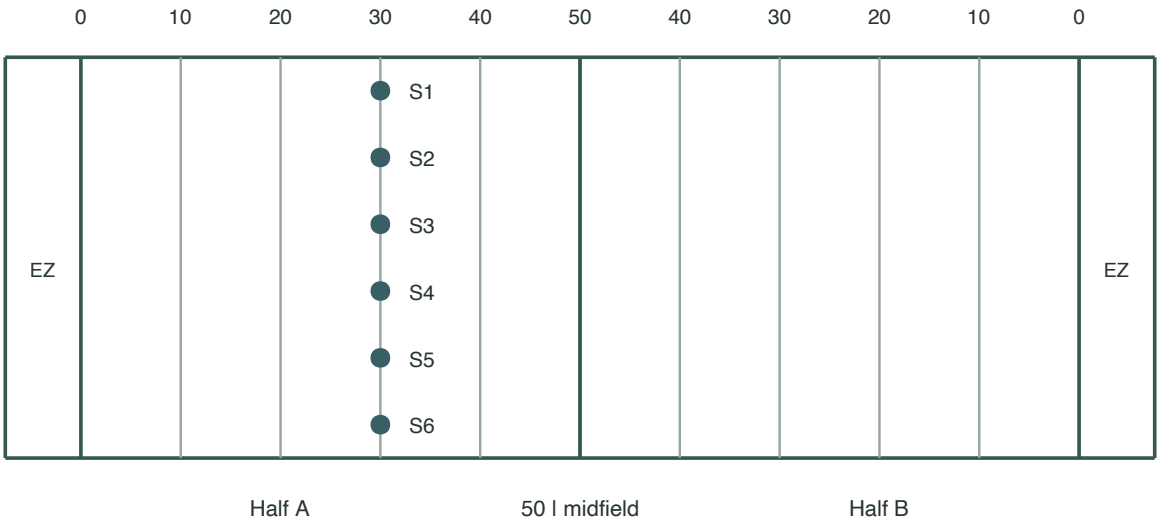

Circle: section S. Centers of six equal lateral slots.

Answer

Put six matching round symbols along the 30-yard line in half A. Divide the lateral span into six equal slots and use their centers. State that placement rule and the symbol in the key.

Reasoning

A single symbol type and stated spacing let a reader confirm the section is one group and the line is regular.

Check

Check that all six symbols lie on the 30-yard line, intervals look equal, and the key names the symbol and spacing.

Marching Band Drill Chart

Answer | Task 3 of 4 | A4

Original prompt

Task 3: The Task 3 figure shows a small chart with two sections on the same yard line, both drawn with the same symbol and with overlapping labels. Redraw it so the two sections use different symbols and their labels do not overlap.

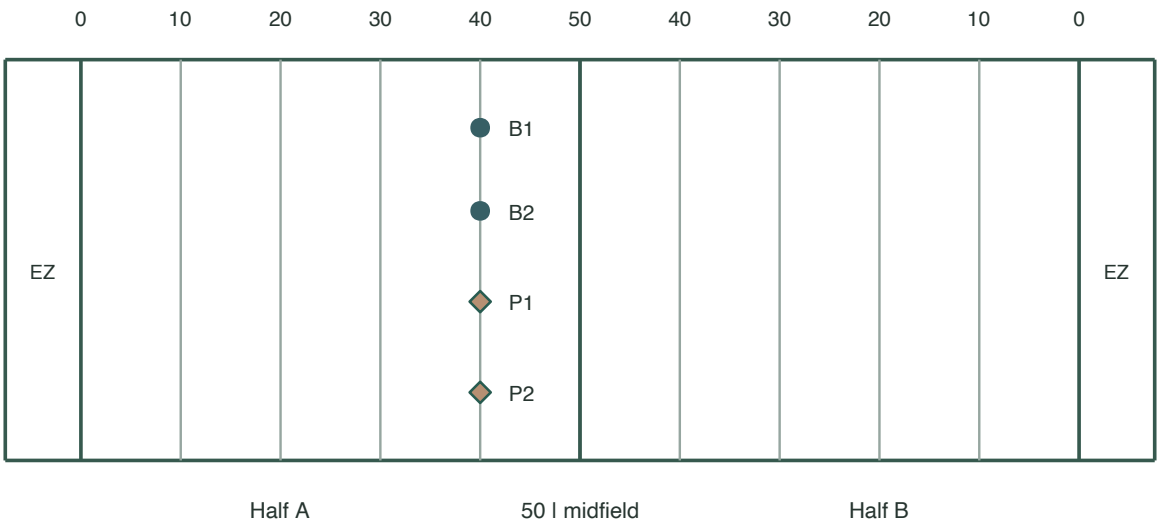

Circle: brass. Diamond: percussion.

Answer

A redrawn chart with two distinct symbol shapes on the shared yard line, labels placed beside each symbol without overlap, and a key naming both symbols.

Reasoning

Distinct symbols and clear label placement make the two sections readable at a glance.

Check

Confirm the two symbol types are visibly different, no labels overlap, and the key explains both symbols.

Marching Band Drill Chart

Original prompt

Task 4: The Task 4 figure shows a supplied drill chart with three faults: a symbol off the grid, a mismatched yard-line label, and overlapping labels. Describe each fault and its correction.

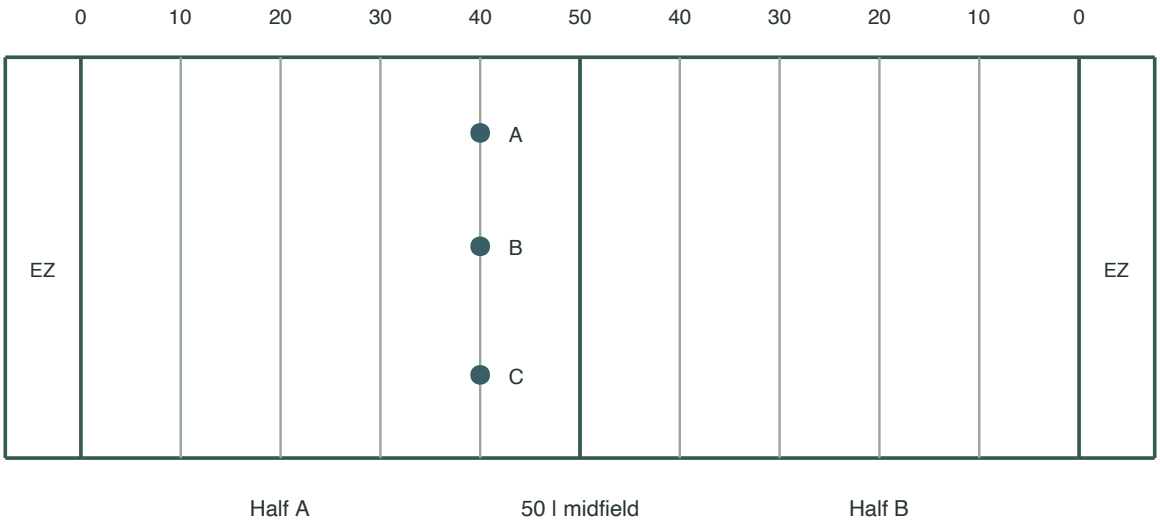

Circle: group members. EZ: end zone.

Answer

C is between yard lines; move it onto half A's 40-yard line. The line at 30 in half A is wrongly labelled 35; relabel it 30. Labels A and B collide; move them beside their own symbols so they no longer touch.

Reasoning

A chart is only usable if positions sit on the grid and labels are readable and correct.

Check

Check that C is on the same 40-yard line as A and B, the A-side 30 label matches its position, and the two labels no longer overlap.