Draw a Two-Point Perspective Landscape

Answer | Task 1 of 4 | A4

Original prompt

Task 1 — Reference-guided redraw: redraw the horizon, both vanishing points, and the main building's two wall directions from the supplied reference, labeling VP-L and VP-R.

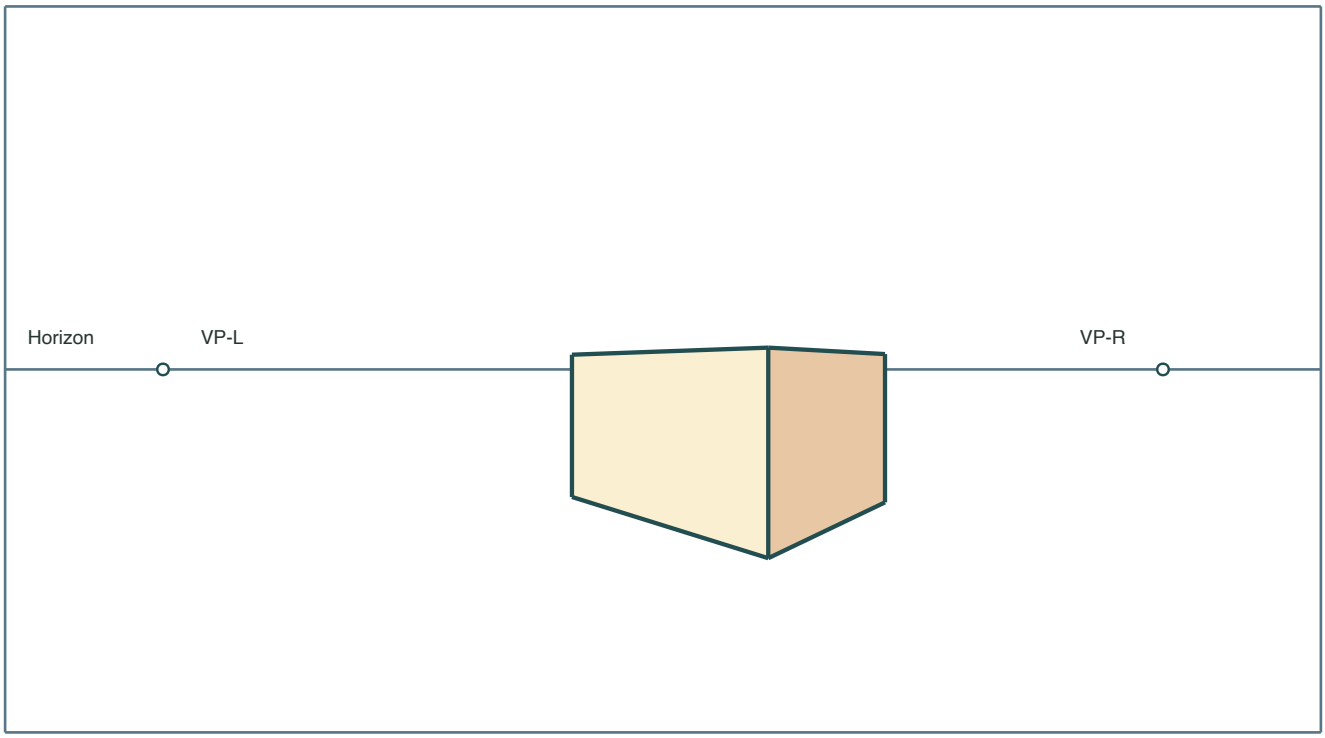

Answer

Horizon line horizontal; VP-L and VP-R marked on it; building's left wall edges converge to VP-L; right wall edges converge to VP-R; corner edges vertical.

Reasoning

Redrawing from a reference trains recognition of which edge family belongs to which vanishing point.

Check

Extend each wall edge; it must meet its labeled vanishing point, and all corner edges must be vertical.

Draw a Two-Point Perspective Landscape

Original prompt

Task 2 — Component construction: on a blank horizon with VP-L and VP-R marked, construct a road converging to VP-L, a field boundary converging to VP-R, and three vertical posts along the road.

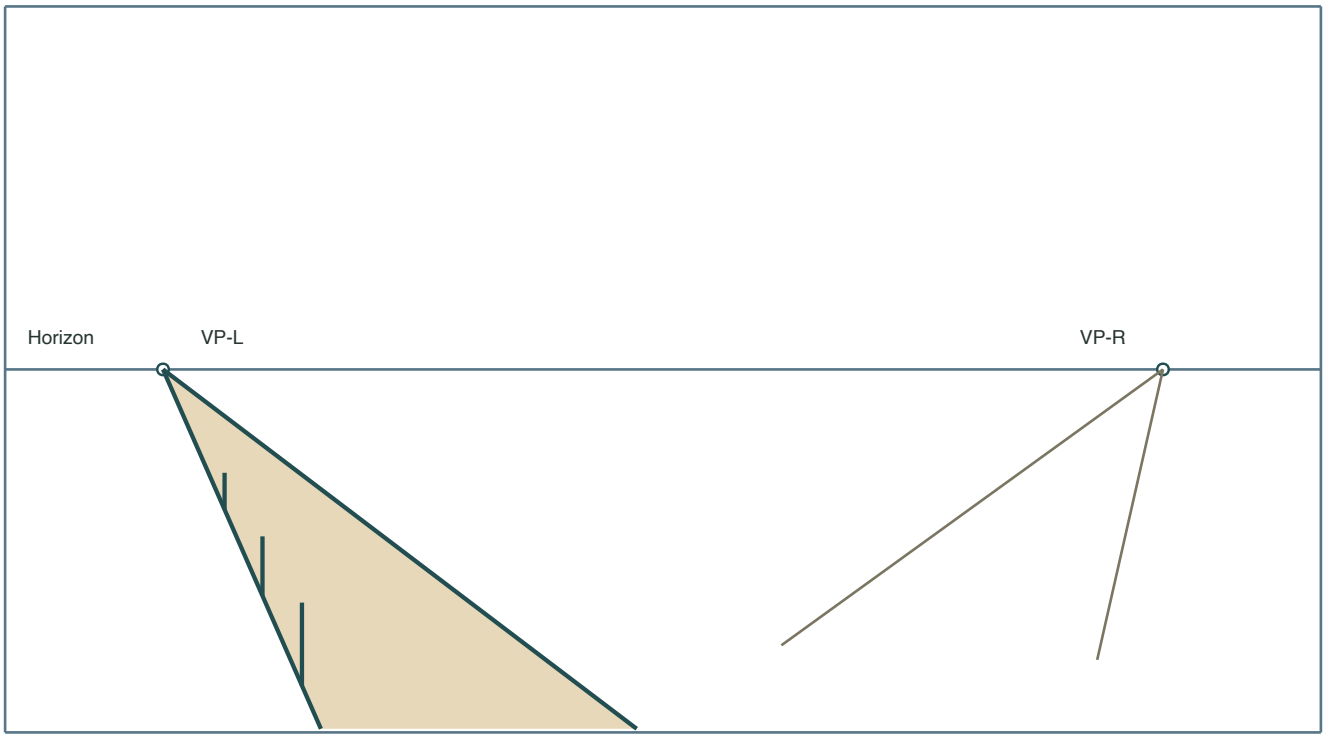

Answer

Two road lines meeting at VP-L; two boundary lines meeting at VP-R; three upright posts.

Reasoning

Separating the two receding directions makes the dual-vanishing-point structure explicit before composing a full scene.

Check

Road lines intersect exactly at VP-L; boundary lines at VP-R; posts are vertical. The three-post count is a classroom choice, not a standard.

Draw a Two-Point Perspective Landscape

Original prompt

Task 3 — Composition: compose a small landscape with one building, a road to VP-L, and a fence to VP-R, placing the building off-center.

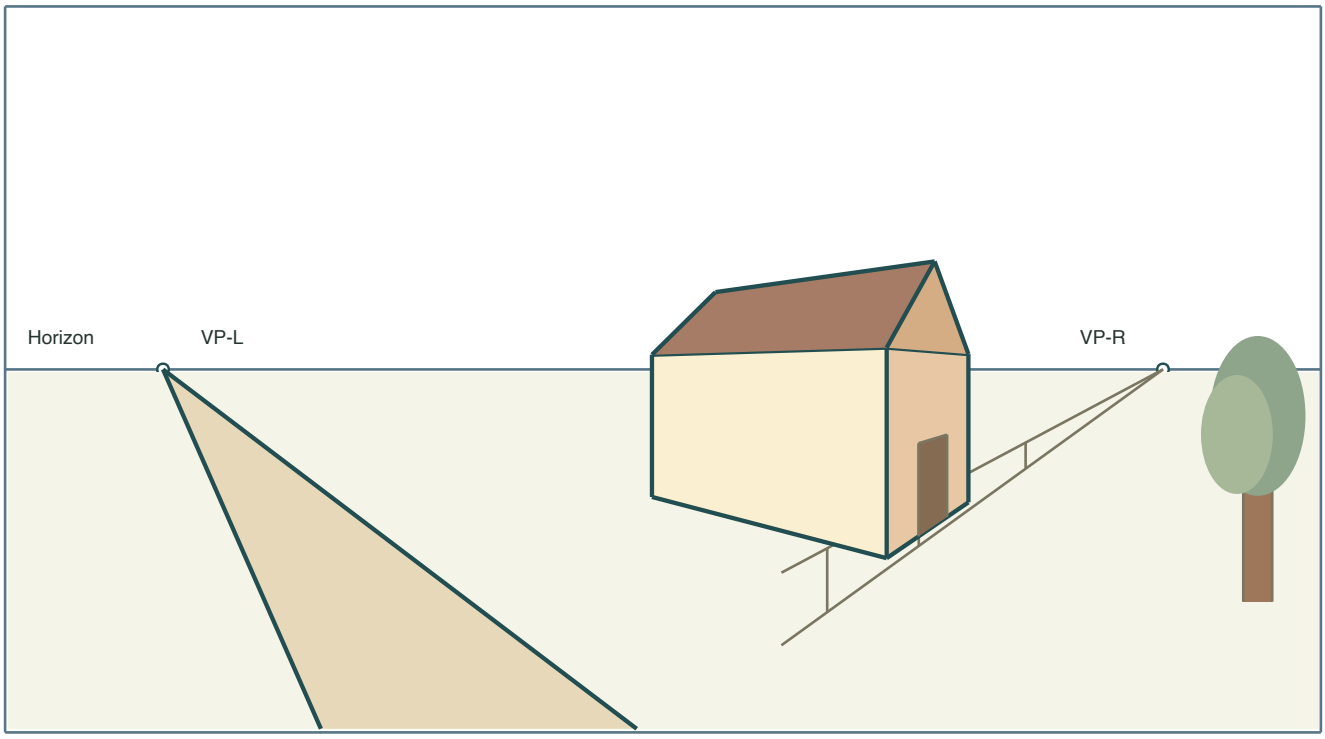

Answer

Building with two wall directions using both vanishing points; road lines to VP-L; fence lines to VP-R; verticals upright.

Reasoning

Composing a scene tests whether both vanishing points can be used together coherently in a landscape.

Check

Check each horizontal wall direction, the road and the fence against the intended horizon point. Check the upright edges separately. The off-center barn should read as part of a landscape.

Draw a Two-Point Perspective Landscape

Original prompt

Task 4 — Visual checking: given a supplied plate with one deliberate perspective error, identify and correct it.

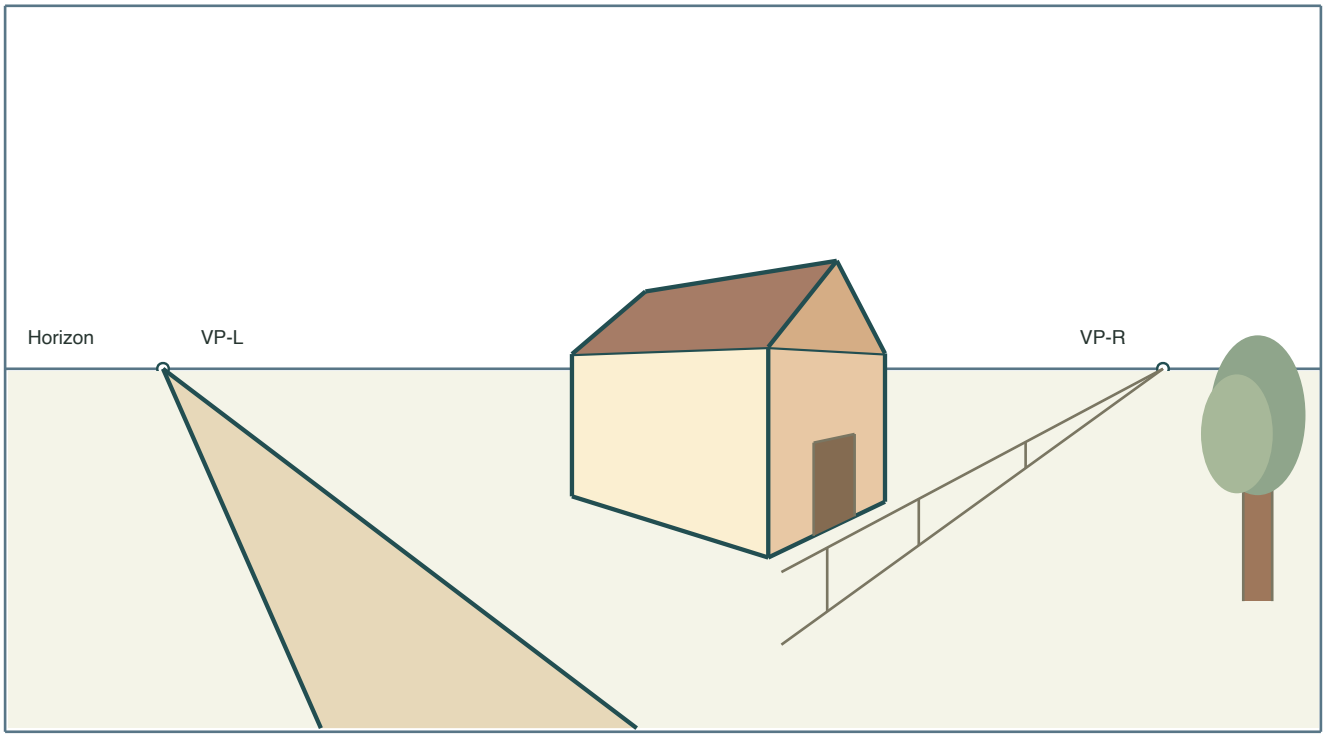

Answer

The right edge of the road ends at VP-R in the given drawing. Keep its starting point at the bottom of the drawing and draw it toward VP-L, beside the other road edge. Leave the fence aimed at VP-R.

Reasoning

Checking against the vanishing points is the core verification skill for two-point perspective.

Check

After correction, both road lines end at VP-L, and the fence still ends at VP-R. Check the horizontal barn edges against their points, and the uprights separately.