Flag Address Labels

Answer | Task 1 of 4 | A4

Original prompt

Task 1: Sketch a label sheet with three labels in one row. Put a different flag variant on each label and a text field beside each flag. Add cut guides around each label.

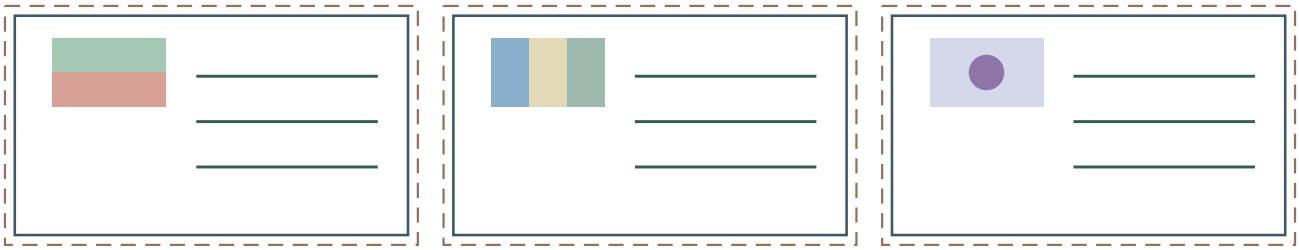

Answer

Three equal labels side by side. Label one has a horizontal-stripe flag, label two a vertical-stripe flag, label three a central-emblem flag. Each flag sits at the left with a text field at the right. Light cut guides border each label.

Reasoning

A single row shows how variants sit side by side and makes the cut guides easy to compare. Keeping the flag left and text right gives a consistent reading order.

Check

Check that all three labels are the same size, each flag is distinct, and no cut guide crosses a text field.

Flag Address Labels

Answer I Task 2 of 4 I A4

Original prompt

Task 2: Take the three-label row from Task 1 and fill the middle label as a model. Write a name line and two address lines inside its text field.



Answer

The middle label is filled with a name line and two address lines inside its text field. The flag and cut guides are unchanged. The other two labels stay blank.

Reasoning

Filling one label in place shows how the text field is used without changing the layout. Leaving the others blank keeps the model clear.

Check

Check that the filled text stays inside the middle label's field and does not touch the flag or the cut guides.

Flag Address Labels

Answer I Task 3 of 4 I A4

Original prompt

Task 3: Redraw the sheet as a two-by-two grid of four labels. Use two flag variants, each repeated twice, and add cut guides between rows and columns.

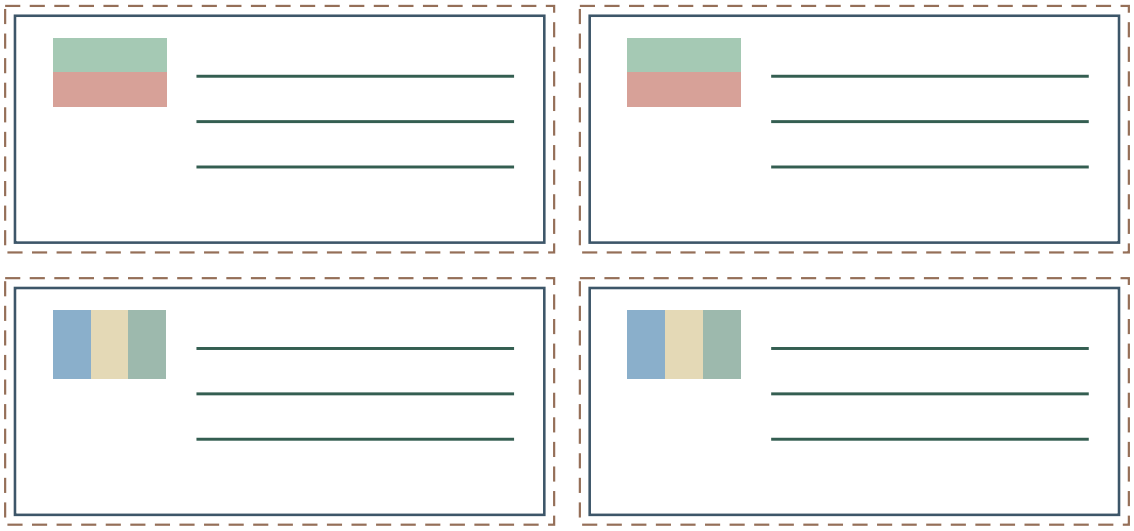

Answer

A two-by-two grid of four equal labels. The top row uses the horizontal-stripe flag twice; the bottom row uses the vertical-stripe flag twice. Each label has a text field beside its flag. Cut guides run between rows and between columns.

Reasoning

A grid shows how repeated variants can be arranged evenly. Repeating each variant twice keeps the sheet simple and the cut guides regular.

Check

Check that the grid spacing is even, each variant appears twice, and the cut guides sit between labels rather than through them.

Flag Address Labels

Answer | Task 4 of 4 | A4

Original prompt

Task 4: Check a finished sheet. The bottom-right label's text runs past its cut guide and the flag overlaps the name line. Describe the two problems and state one fix for each.

Given sheet. Inspect the bottom-right label.

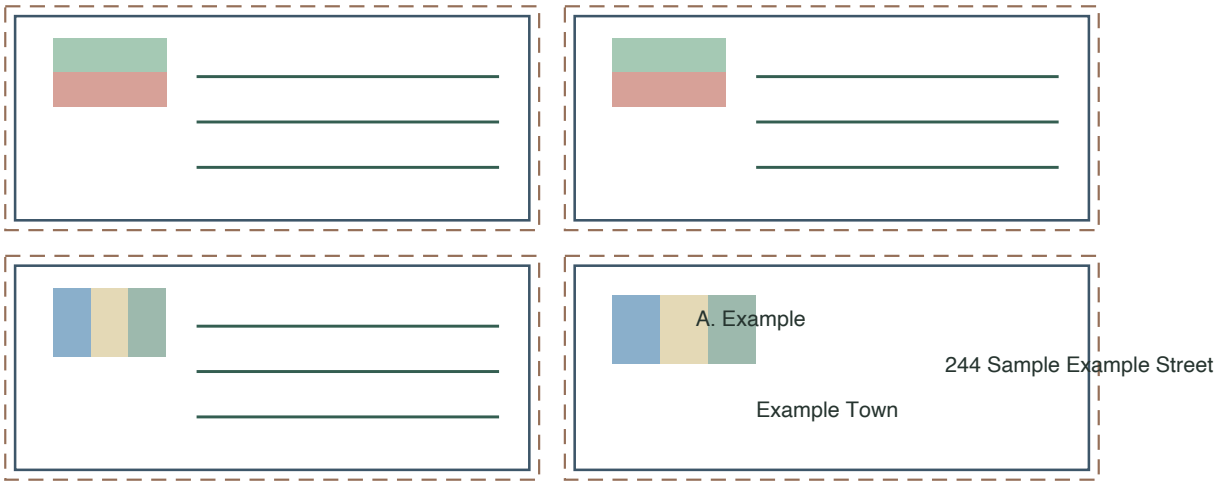

Corrected bottom-right label



Answer

Problem one: the text crosses the cut guide, so the address would be trimmed. Fix: move the text field inward or shorten the lines. Problem two: the flag overlaps the name line, so the name is hard to read. Fix: move the flag to the top of the label or shrink it.

Reasoning

Both problems come from elements placed outside their own areas. Moving or resizing the element restores the separation the layout needs.

Check

Check that after each fix the text stays inside its field and the flag no longer touches the name line.