Draw Missing Orthographic View

Student | Task 1 of 4 | A4

Original prompt

Task 1: Given front and top views of a block with a rectangular notch cut from the top, draw the missing right side view.



Top

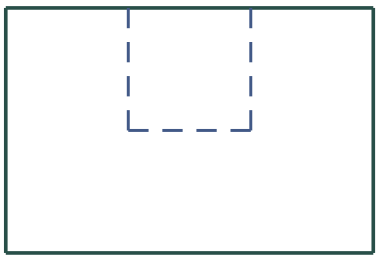

Front



Right side to draw

Your drawing and alignment check

Draw Missing Orthographic View

Student | Task 2 of 4 | A4

Original prompt

Task 2: Given front and right side views of a block with a vertical slot on its left face, draw the missing top view.



Top to draw



Front

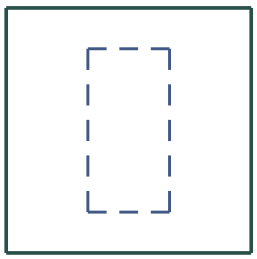

Right side

Your drawing and alignment check

Draw Missing Orthographic View

Student | Task 3 of 4 | A4

Original prompt

Task 3: Given top and right side views of a block with a raised rectangular boss on its front face, draw the missing front view.

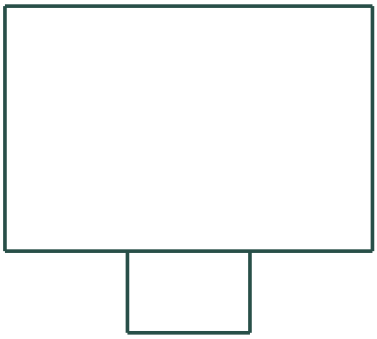

Top



Front to draw

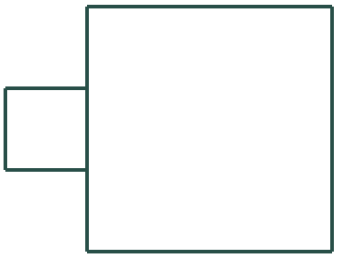

Right side

Your drawing and alignment check

Draw Missing Orthographic View

Student | Task 4 of 4 | A4

Original prompt

Task 4: Given front and top views of a block with a through-hole drilled vertically, draw the missing right side view.



Top

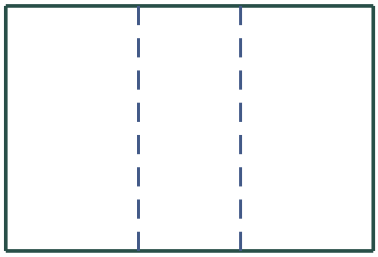

Front



Right side to draw

Your drawing and alignment check