Baseball Diamond Diagram

Student | Task 1 of 4 | LETTER

Original prompt

Task 1 — Label the diamond. A plan is drawn with a square turned on its corner and a home plate at the bottom corner. Label the three remaining base corners in the correct order and state which direction a runner travels around the diamond.

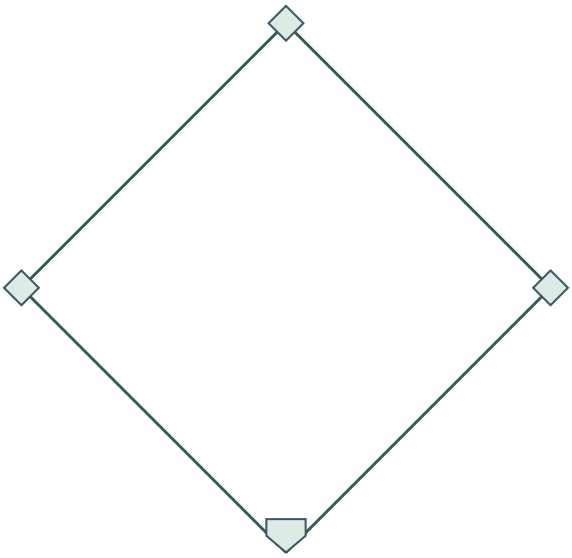

Home plate

Record your placement and reasoning

Baseball Diamond Diagram

Student | Task 2 of 4 | LETTER

Original prompt

Task 2 — Place the mound. On the same diamond plan, describe where the pitcher's mound goes and draw it. Explain how you decided its position.

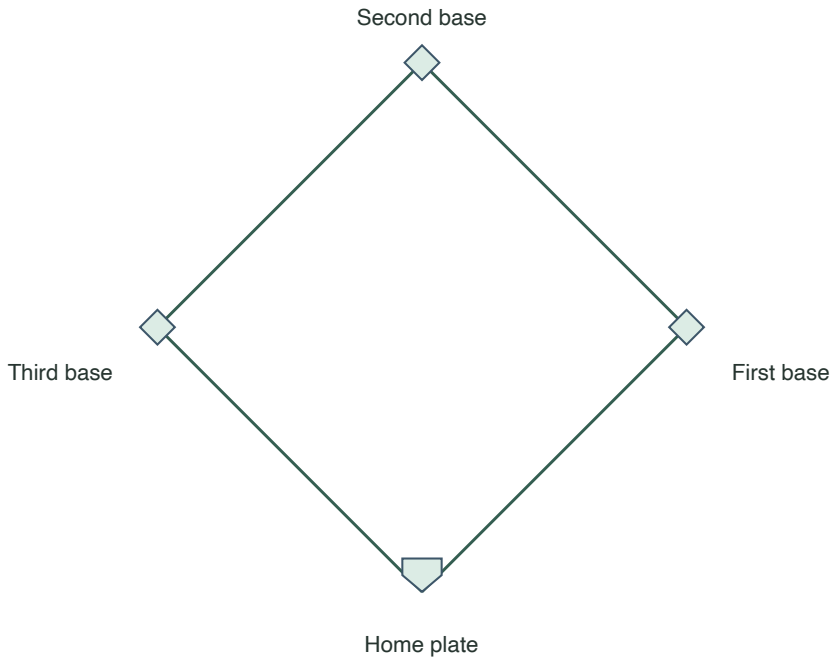

Record your placement and reasoning

Baseball Diamond Diagram

Student | Task 3 of 4 | LETTER

Original prompt

Task 3 — Draw the foul lines. From home plate, draw the two foul lines and state which bases each line passes through and where each line ends on the diagram.

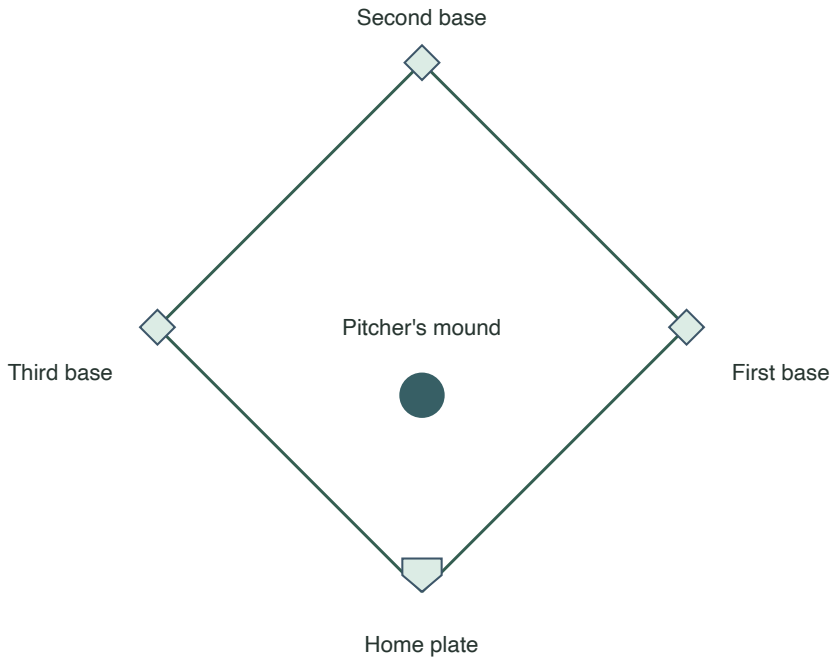

Record your placement and reasoning

Baseball Diamond Diagram

Student | Task 4 of 4 | LETTER

Original prompt

Task 4 — Redraw and check. Redraw the complete diagram (diamond, four bases, mound, two foul lines) from the reference, then run the four-point check and note any correction you had to make.

Redraw the diamond and record your correction