Blank Tables and Graphs

Student | Task 1 of 4 | A4

Original prompt

Task 1: A table is titled 'Temperature through the day' with columns 'Time' and 'Temperature'. The graph frame has no axis labels. Add the correct axis labels and say which variable is on which axis.

Temperature through the day

Time	Temperature

Temperature through the day



Your labels and check

Blank Tables and Graphs

Student | Task 2 of 4 | A4

Original prompt

Task 2: Two blank tables and two blank graph frames are shown with different headings. Decide which table pairs with which frame and state the matching rule.

Walk record

Distance	Time

Room warmth

Temperature



Hour

Room warmth

Hour	Temperature

Walk record

Time



Distance

Your labels and check

Blank Tables and Graphs

Student | Task 3 of 4 | A4

Original prompt

Task 3: Redraw a given paired organizer so that its graph frame matches its table. The supplied table has headings 'Distance' and 'Time'; the supplied frame has swapped axis labels. Correct the frame.

Trip record

Distance	Time

Trip record

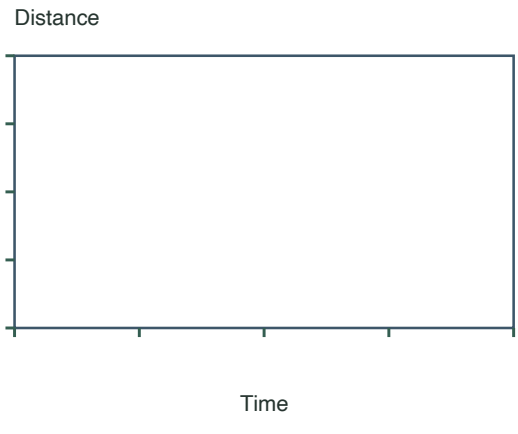

Your labels and check

Blank Tables and Graphs

Student | Task 4 of 4 | A4

Original prompt

Task 4: Check a supplied paired organizer and list what is wrong. The supplied organizer has a table titled 'Growth' and a frame titled 'Height', with axis labels that do not match the table columns.

Growth

Day	Height (cm)

Height

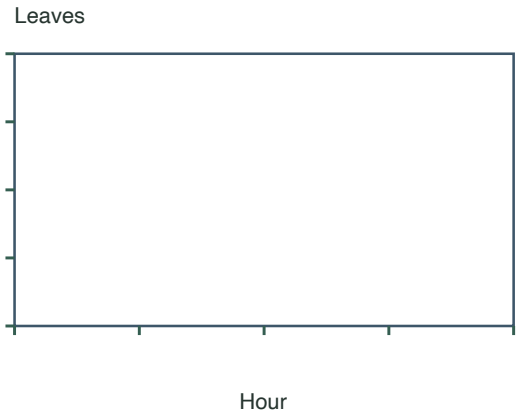

Your labels and check