Fictional art supplies

Fictional category counts. Use equal-width bars with spaces between them. The vertical count axis starts at zero.

Counts: Pencil=6, Pen=10, Brush=4, Chalk=8

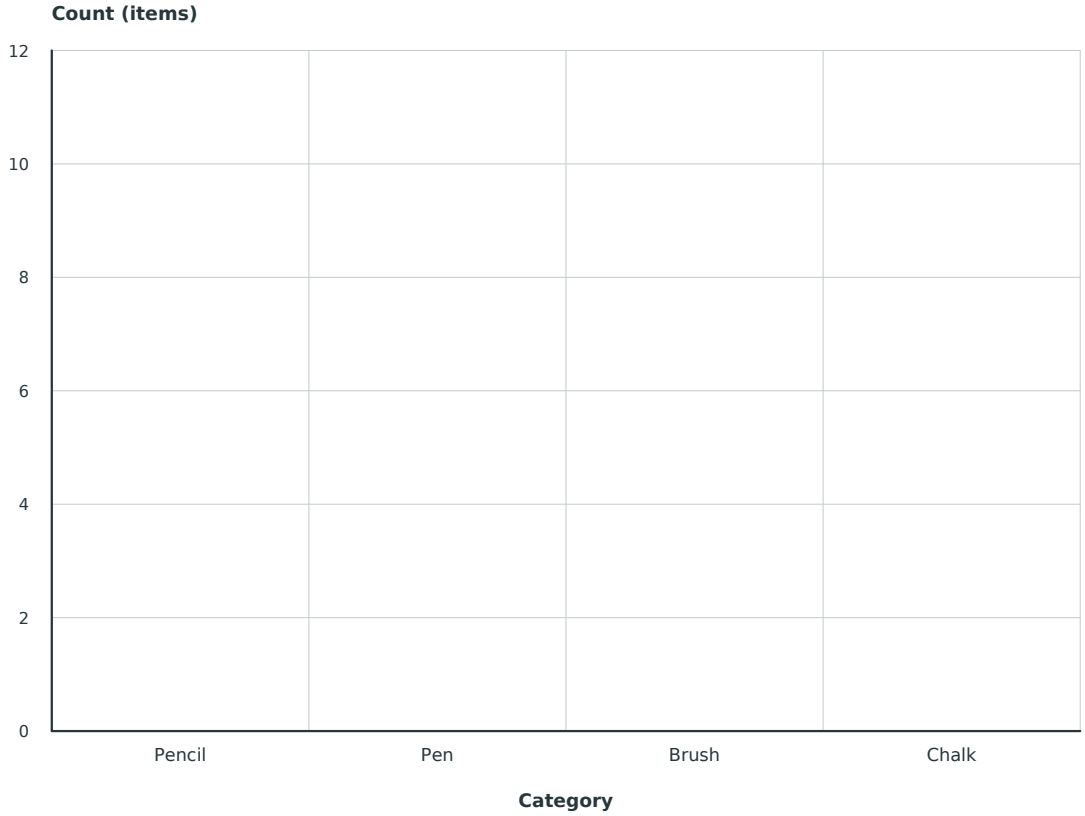

1. Which categories have the largest count? _____

2. Total number of items? _____

3. Largest count minus smallest count? _____

Original practice data / coordinate units, not ruler measurements / physical printing not tested

Zumola / CC BY 4.0 / Free to print, share and adapt with attribution

Made-up shape cards

Fictional category counts. Use equal-width bars with spaces between them. The vertical count axis starts at zero.

Counts: Circle=7, Square=5, Star=7, Oval=3

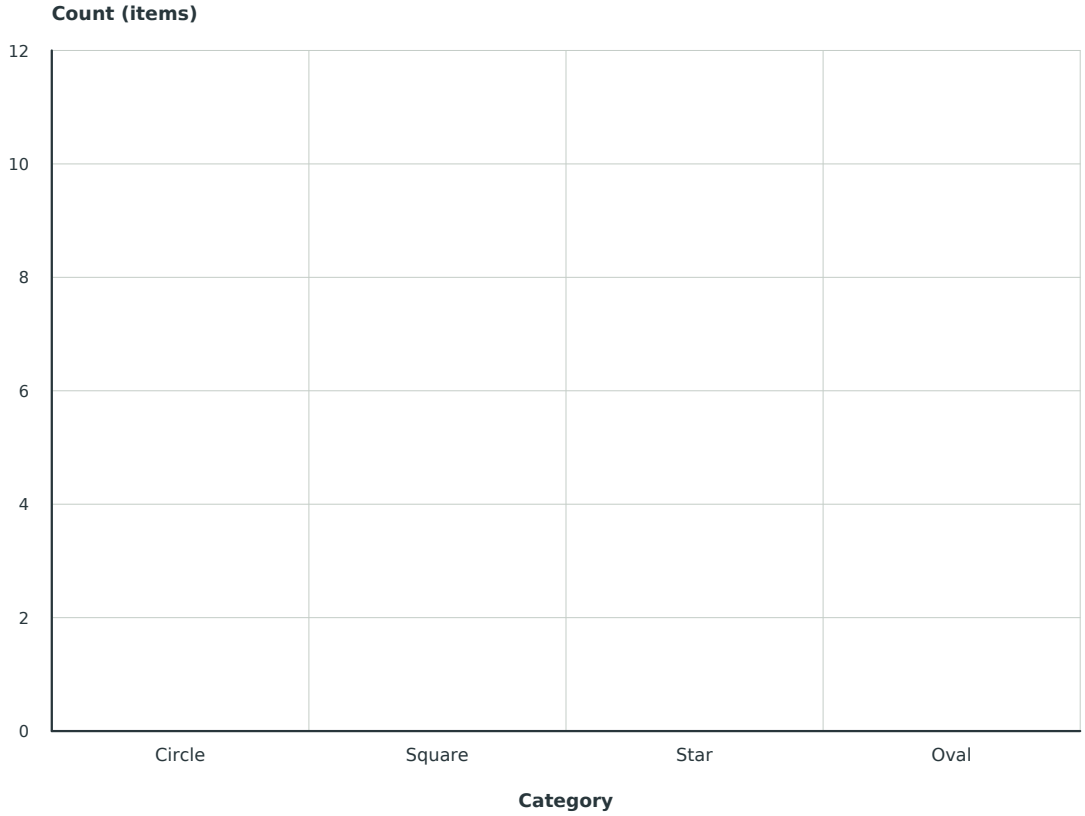

1. Which categories have the largest count? _____

2. Total number of items? _____

3. Largest count minus smallest count? _____

Original practice data / coordinate units, not ruler measurements / physical printing not tested

Zumola / CC BY 4.0 / Free to print, share and adapt with attribution

Fictional plant cards

Fictional category counts. Use equal-width bars with spaces between them. The vertical count axis starts at zero.

Counts: Mint=5, Moss=9, Fern=3, Palm=7

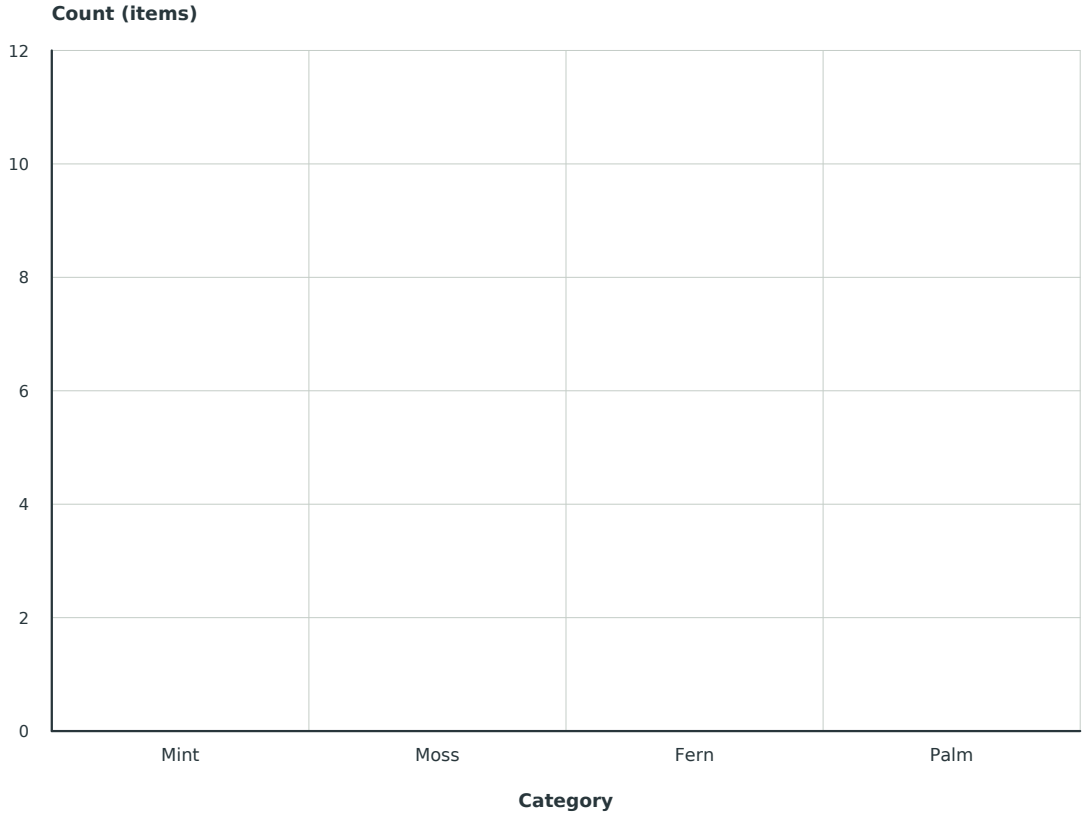

1. Which categories have the largest count? _____

2. Total number of items? _____

3. Largest count minus smallest count? _____

Original practice data / coordinate units, not ruler measurements / physical printing not tested

Zumola / CC BY 4.0 / Free to print, share and adapt with attribution

Imaginary tile colors

Fictional category counts. Use equal-width bars with spaces between them. The vertical count axis starts at zero.

Counts: Slate=8, Moss=4, Clay=10, Sand=6, Ink=2

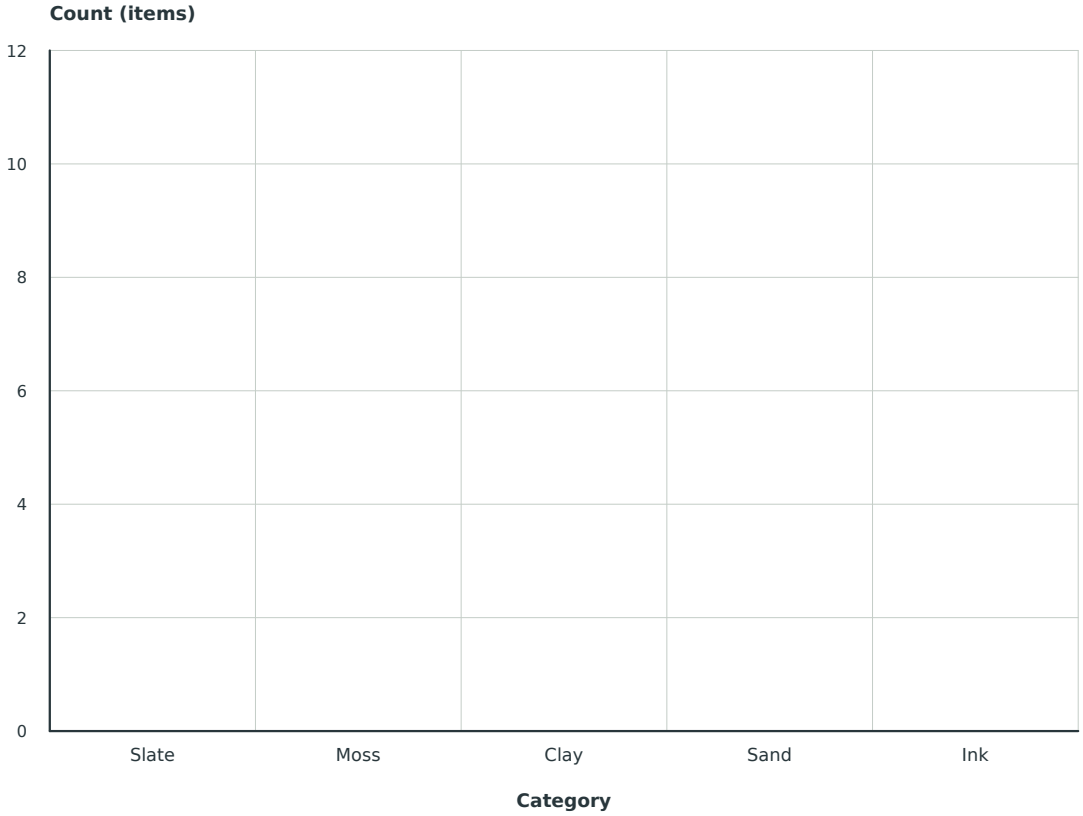

1. Which categories have the largest count? _____

2. Total number of items? _____

3. Largest count minus smallest count? _____

Original practice data / coordinate units, not ruler measurements / physical printing not tested

Zumola / CC BY 4.0 / Free to print, share and adapt with attribution